Name:_____

Circles

Name the red part in each circle.

1) 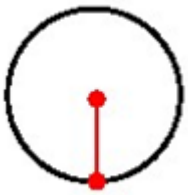

_____

2) 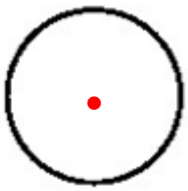

_____

3) 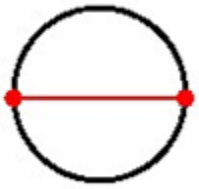

_____

4) 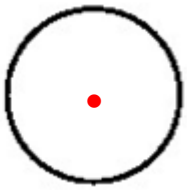

_____

5) 

_____

6)

_____